Name: _____

Verdoppeln

1 Zeichne das Spiegelbild dazu und rechne.

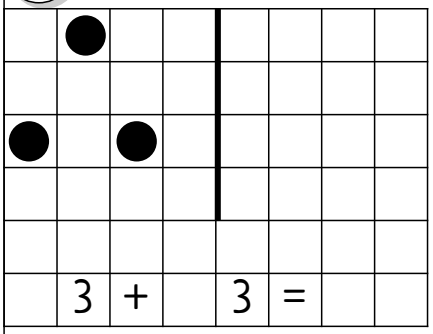

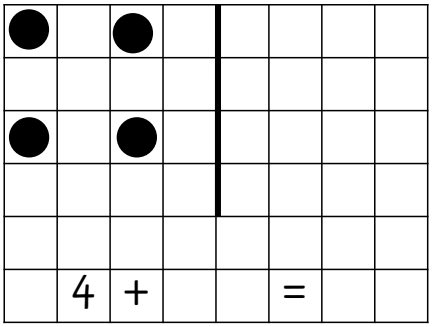

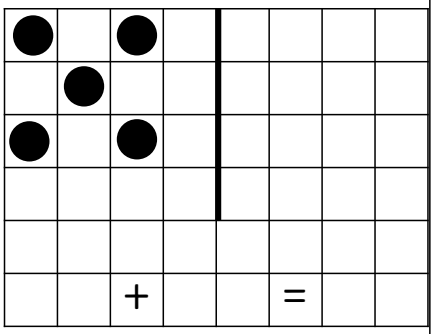

2 Zeichne das Spiegelbild dazu und rechne. Achte genau auf die Kästchen.

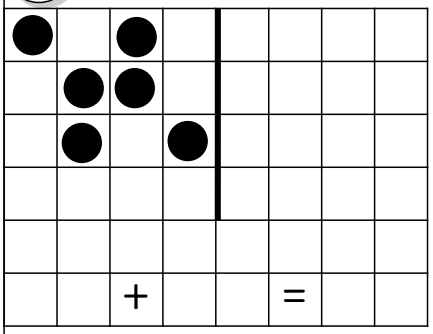

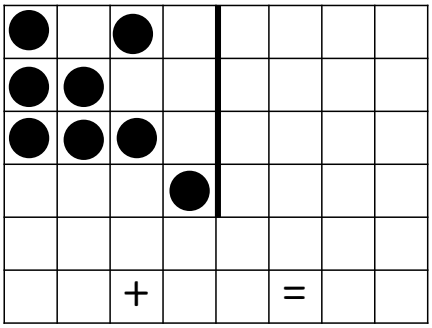

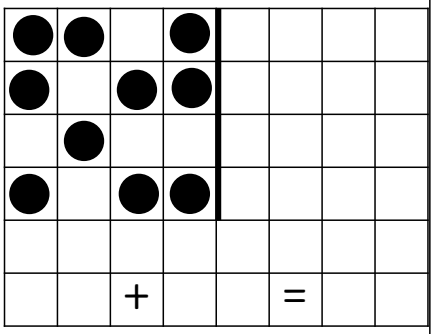

3 Verdopple. Zeichne und rechne

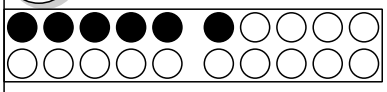

6 + 6 = ___

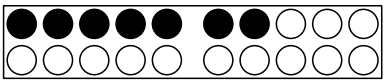

7 + ___ = ___

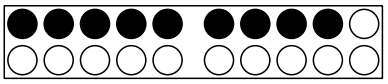

___ + ___ = ___

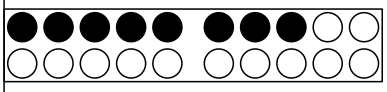

___ + ___ = ___

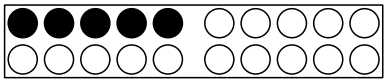

___ + ___ = ___

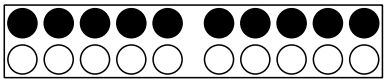

___ + ___ = ___

4 Verdoppeln hilft.

5 + 5 = ☐	6 + 6 = ☐	1 + 1 = ☐
2 + 2 = ☐	4 + 4 = ☐	8 + 8 = ☐
10 + 10 = ☐	9 + 9 = ☐	10 + 10 = ☐
8 + 8 = ☐	7 + 7 = ☐	6 + 6 = ☐
3 + 3 = ☐	2 + 2 = ☐	7 + 7 = ☐